HRADIŠTĚ B DÚ12a 23.11.2020,
Taktika a koncovky

první strana ze dvou

1.příklad Bílý na tahu (pš 2/173)



?

2.příklad Bílý na tahu (pš 4/189)



?

3.příklad Bílý na tahu (pš x058)



?

4.příklad Bílý na tahu (pš 2/131)



?

<u>HRADIŠTĚ B DÚ12a 23.11.2020,</u>
<u>Taktika a koncovky</u>
(Biolek 007,4x)

!!! Pod každý diagram napište první tah a jak partie dopadne !!!
(navíc můžete v diagramech označit KP)
druhá strana ze dvou



1.příklad Bílý na tahu

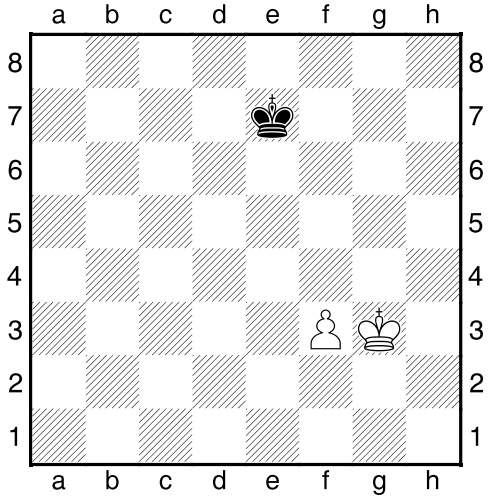

2.příklad Černý na tahu

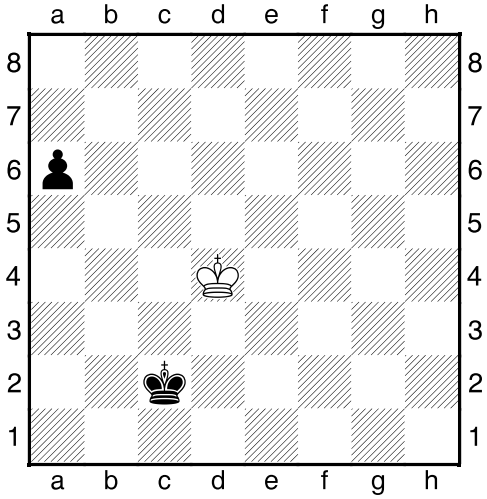

3.příklad Černý na tahu

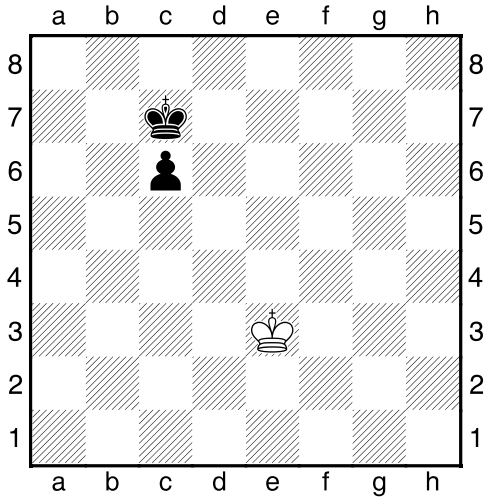
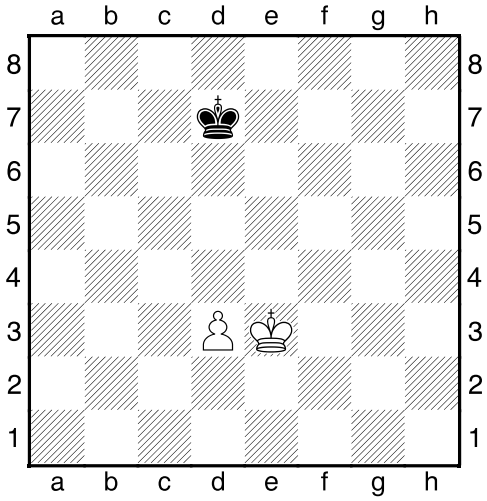
4.příklad Černý na tahu